# ทรงเรขาคณิต

ทรงกลม

ทรงปริซึม

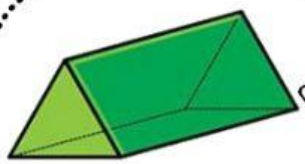

ทรงกรวย

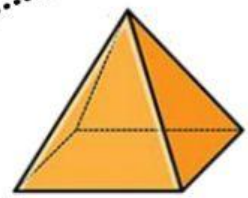

ทรงกระบอก



ทรงพีระมิด

ชื่อ.....เลขที่.....ชั้น.....

LIVEWORKSHEETS