Name:_____ Module 5 Topic A Quiz

Label each tape diagram. Then write the number sentence shown by each diagram.

a.

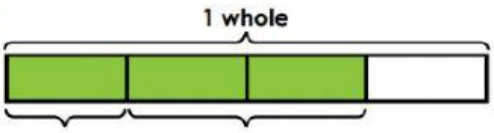

number sentence: _____

b.

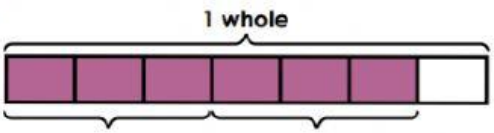

number sentence: _____

c.

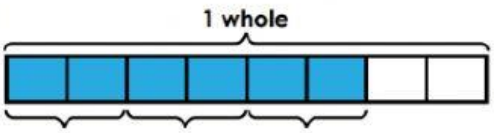

number sentence: _____

d.

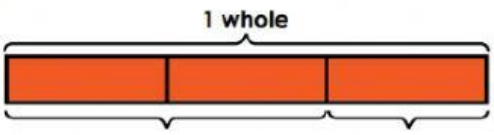

number sentence: _____

Match the number sentence with the tape diagram

$$\frac{3}{6} + \frac{1}{6} + \frac{1}{6} = \frac{5}{6}$$

$$\frac{2}{6} + \frac{3}{6} = \frac{5}{6}$$

$$\frac{2}{8} + \frac{1}{8} + \frac{3}{8} = \frac{6}{8}$$

$$\frac{3}{8} + \frac{3}{8} + \frac{1}{8} = \frac{7}{8}$$

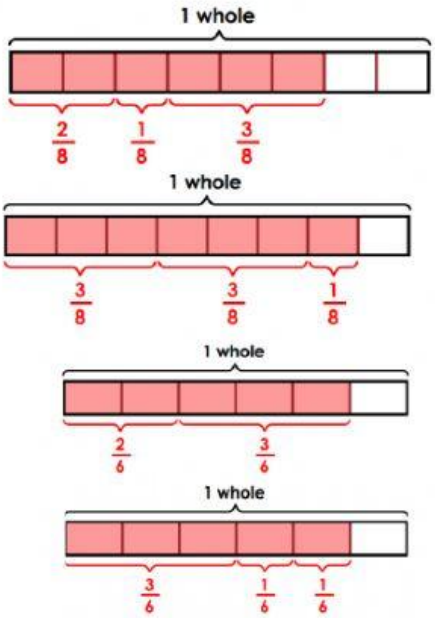

LIVEWORKSHEETS

Name:_____ Module 5 Topic A Quiz

Use the models to find equivalent fractions.

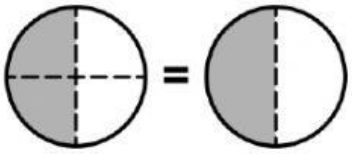

$\frac{2}{4} = \frac{\quad}{2}$

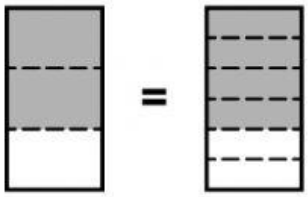

$\frac{2}{3} = \frac{\quad}{6}$

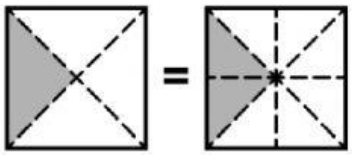

$\frac{1}{4} = \frac{\quad}{\quad}$

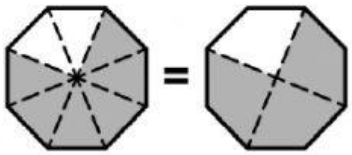

$\frac{6}{8} = \frac{\quad}{\quad}$

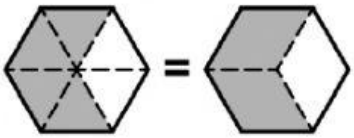

$\frac{\quad}{\quad} = \frac{\quad}{\quad}$

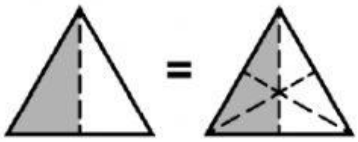

$\frac{\quad}{\quad} = \frac{\quad}{\quad}$

LIVEWORKSHEETS