MATH QUIZ

5th grade – II Partial

Student's Name: _____

Teacher's Name: Idalia Suazo **Score:** _____

School Year: 2020 – 2021 **Points: 30%**

Topics: Averaging numbers, Division with a two-digit divisor, Estimating Quotients.

Date: _____

Teacher Comment:

PART I. TRUE OR FALSE 5 pts. (1 pt. each)

INSTRUCTIONS: Write in the parenthesis a **T** if the statement is true and an **F** if it is false. **If the answer is false, justify your answer by filling in the blank.**

1. To find the **average**, divide the sum by the number of addends..... ☐
   _____
2. **Estimate a quotient** is to make misjudgment about what number to place in the quotient ..... ☐
   _____
3. Estimate, divide, multiply, subtract, compare, and bring down are **steps** in complex division ..... ☐
   _____
4. 1992 ÷ 83 = **45** ..... ☐
   _____
5. 432 × 461 = **199,152**..... ☐
   _____

PART II. COMPLETE 10 pts. (1 pt. each)

a) INSTRUCTIONS: Complete the exercises writing **the missing number**.

a. _____ ÷ 12 = 4

b. 9 × _____ = 72

c._____+ 37 =103

d. _____ - 34 =17

e. 456 ÷ _____ =76

f. 74,973 × 17 =_____

g. _____+344 = 944

h._____ - 7,483 = 4,885

I. 200 × _____ = 1,000

j. _____ × 4 = 48



LIVEWORKSHEETS

PART II. MATCHING 6 pts. (1 pt. each)

Instructions: Read the number and write the value of each number from column A to column B.



a) 7,345,621

COLUMN A	COLUMN B						
	M	HTH	TTH	TH	H	T	O
a. 554							
b. 8,938							
c. 98							
d. 1,000,000							
e. 74,693							

PART III. PRACTICE 14 pts.

INSTRUCTIONS: Solve the following exercises about the Basic Math Operations

1. ***Solve the following AVERAGE NUMBERS. (4 pts. – 2 e/o)***

a) 92 87 89 94 75 91	b)67;23;42;38;25;30;27

LIVEWORKSHEETS

2. *Solve the following MULTIPLICATIONS. (4 pts. – 1 e/o)*

a) 948 × 9	b) 672455 × 8
c) 57 × 69	d) 679 × 483

3. *Solve the following divisions (Estimate Quotients) (6 pts.- 2 e/o)*

a) 29) 7656	b) 86) 648912
c) 77) 7656	

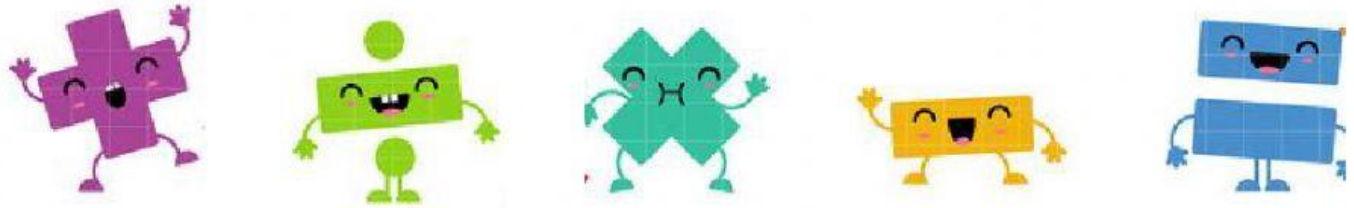

LIVEWORKSHEETS

Mrs. Idalia Suazo

LIVEWORKSHEETS