BANGUN DATAR



Nama: _____.

Kelas: _____.

@tadrismatematika_uinsuthajambi

LIVEWORKSHEETS

Tontonlah vidio berikut

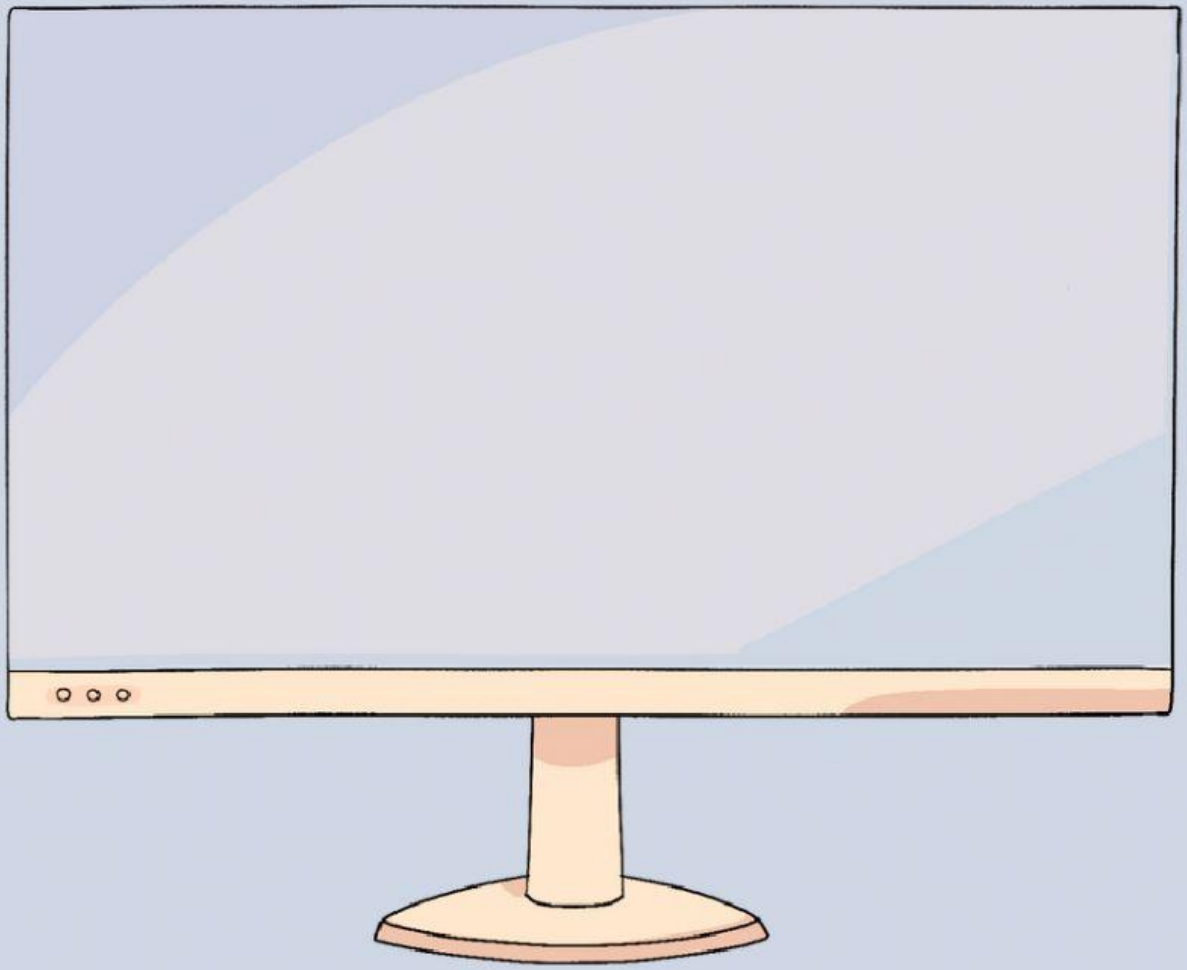

LIVEWORKSHEETS

Soal Pilihan Ganda

1. Panjang diagonal belah ketupat adalah 8 cm dan 6 cm. Maka luasnya adalah...

a. 24 cm²

b. 26 cm²

2. Berapa diagonal balah ketupat .....

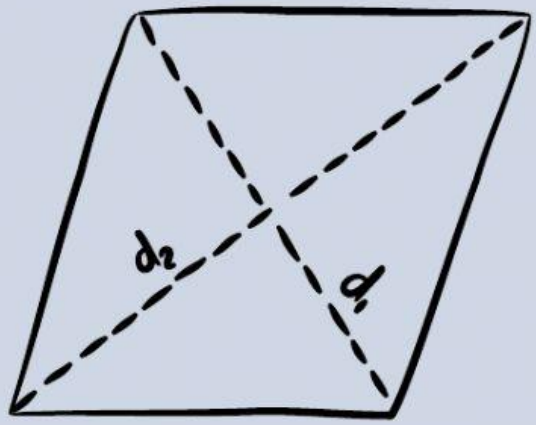

LIVEWORKSHEETS

Join arrow

Pasangkan gambar bangun datar dibawah ini dengan rumus luas bidang yang benar



- **L = π × r × r**

- **L = ½ × d1 × d2**



- **L = alas x tinggi atau a x t.**

LIVEWORKSHEETS