Name : _____

Counting Cubes - Rectangular Prisms

ES1

Count the unit cubes and find the volume of each rectangular prism. = 1 ft^3

1)



Volume = _____

2)

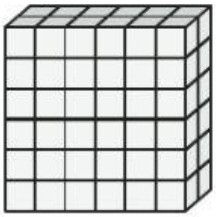

Volume = _____

3)



Volume = _____

4)



Volume = _____

5)

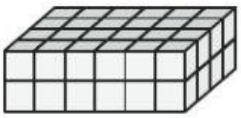

Volume = _____

6)



Volume = _____

7)



Volume = _____

8)

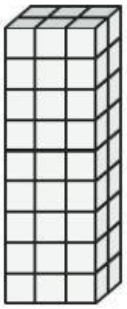

Volume = _____

9)



Volume = _____

LIVEWORKSHEETS
LIVEWORKSHEETS