CLASS: IV **CHAPTER 1: BUILDING WITH BRICKS**

SUB: MATHS **NAME:_____**

ANSWER THE FOLLOWING:

1.How many bricks are used in the following figure? _____



2.Which design of the wall is expected to be the weakest? _____

A B



3.Which type of design you can see in this picture? _____

4.Identify the shape of brick pattern in the given picture_____

5.In the given brick ,red side refers to _____view.

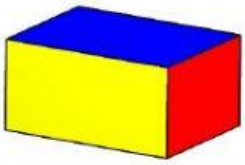

LIVEWORKSHEETS