GEOMETRIJSKA TIJELA

1. Spoji pravilni poliedar sa njegovim imenom:
(JOIN WITH ARROWS - SPAJANJE STRELICAMA)

TETRAEDAR

KOCKA

DODEKAEDAR

IKOSAEDAR

OKTAEDAR

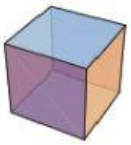

2. Pravilni poliedri nazivaju se još i _____ ,
(POPUNJAVANJE PRZNOG POLJA)

LIVEWORKSHEETS

3. Razvrstaj:

(DRAG AND DROP)

Prizma | Piramida | Valjak | Stožac | Kugla | Kocka

Poliedri	Rotacijska tijela

4. Koje od ovih formula predstavljaju formulu za oplošje (može biti točno više odgovora):
(MULTIPLE CHOICE – VIŠESTRUKI IZBOR)

$2B + P$ | $\frac{1}{3} \cdot B \cdot v$ | $B \cdot v$ | $B + P$

5. Popuni rečenice:
(POPUNJAVANJE PRAZNOG POLJA I SELECTION BOXES –KUTIJE ZA ODABIR)

Pobočka piramide je _____ .

Sve pobočke čine _____ ili _____ .

Osnovica piramide je _____ .

Brid u kojemu se sastaju osnovica i pobočka naziva se _____ brid.

Udaljenost vrha piramide i ravnine baze je _____ piramide.

LIVEWORKSHEETS

6. Stavi kvačicu ✓ kod pojedinog geometrijskog tijela: (TICK BOXES)

	Prizma	Piramida	Rotacijsko tijelo
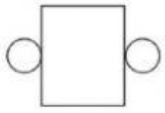			
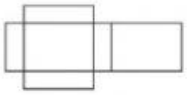			
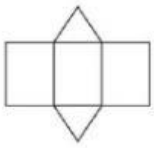			
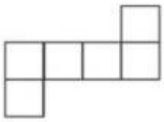			
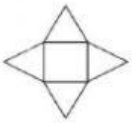			
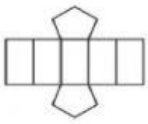			

LIVEWORKSHEETS

7. Dovuci naziv ispod odgovarajućeg geometrijskog tijela:
(DRAG & DROP – POVUCI I ISPUSTI)

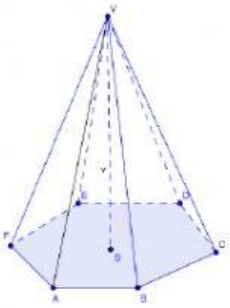

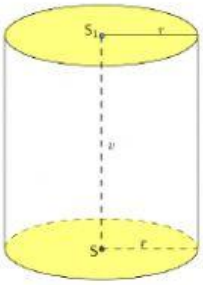

PRIZMA

PIRAMIDA

VALJAK

STOŽAC

KUGLA

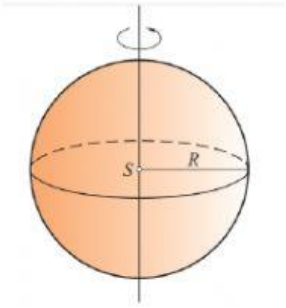

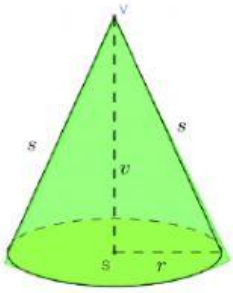

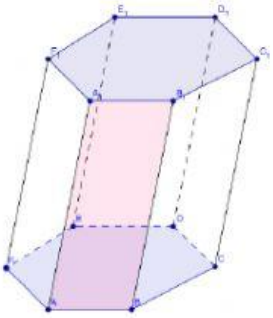

LIVEWORKSHEETS