Geometry

Past BJC Paper 1 question

1. For each of the angles marked in the pictures below, write down the name of the angle

obtuse angle, right angle, acute angle, reflex angle



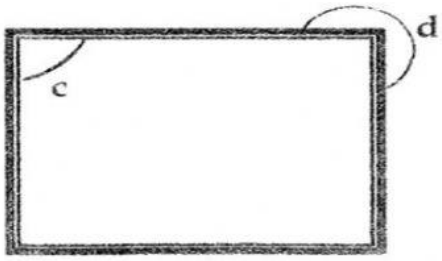

Answer a _____ [1]

Answer b _____ [1]

Answer c _____ [1]

Answer d _____ [1]

2.

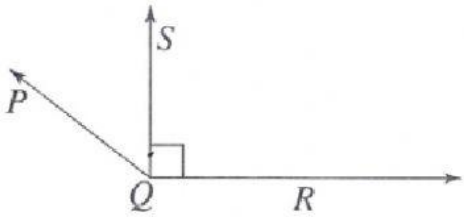

Use the figure above to answer the questions below.

(a) _____ is an acute angle.

(b) _____ is an obtuse angle.

(c) _____ is a line perpendicular to another line

LIVEWORKSHEETS