**Year 4 Maths** **Term 2 Week 6 Lesson 1**

LO: To understand the place value of tents

Drag and drop the numbers into the correct place and then fill in the fraction.

0.5 0.7 0.3 0.9 0.2 0.1

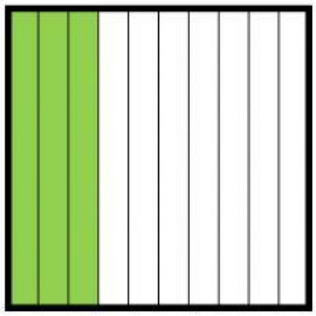

$\frac{\quad}{10}$ = ☐

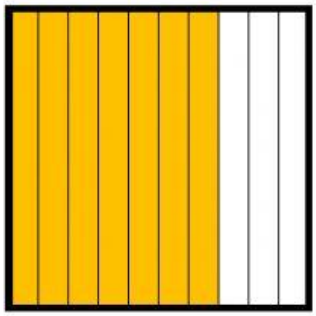

$\frac{\quad}{10}$ = ☐

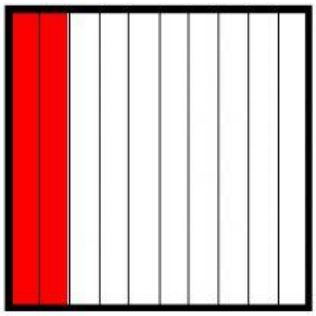

$\frac{\quad}{10}$ = ☐



$\frac{\quad}{10}$ = ☐

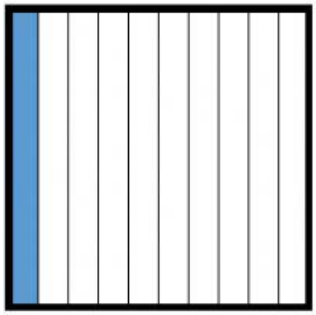

$\frac{\quad}{10}$ = ☐



$\frac{\quad}{10}$ = ☐

LIVEWORKSHEETS

## Activity 2:

**Convert between these fractions and decimals**

$\frac{4}{10}$ = ☐

☐ $\frac{\quad}{10}$ = 0.8

## Activity 3: (We use a full stop NOT a comma)

Challenge 2

1 Write the decimal fraction that is of equal value to these fractions.

a $\frac{3}{10}$ b $\frac{8}{10}$ c $\frac{1}{10}$ d $\frac{4}{10}$ e $\frac{7}{10}$

## Extension activity (We use a full stop NOT a comma)

Challenge 3

1 What is the decimal fraction that is of equal value to these mixed numbers?

a $1\frac{3}{10}$ b $1\frac{7}{10}$ c $2\frac{4}{10}$ d $2\frac{8}{10}$ e $3\frac{1}{10}$

**Decimal Numbers-Tenths and Hundredths**

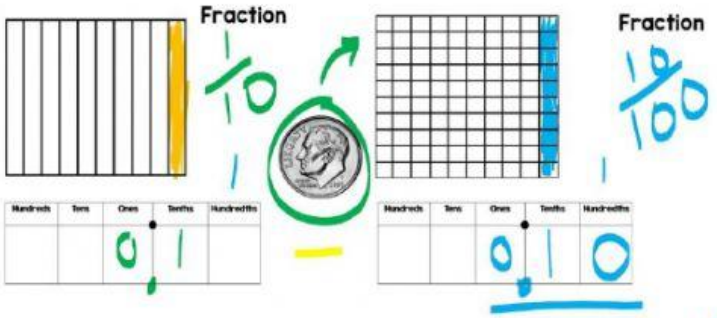


LIVEWORKSHEETS