ZAKHER PRIVATE SCHOOL

LO: To be able to understand the division as equal sharing.

Task 1: Divide the given pictures into equal groups.

1) How many groups of 3? ____



2) How many groups of 4? ____



3) How many groups of 2? ____

4) How many groups of 5? ____

5) How many groups of 10? ____



6) How many groups of 3? ____

Task 2: Do as directed.

Use the pictures to help you to work out the division problems.

1) 8 ÷ 2 = ____

2) 10 ÷ 5 = ____

3) 9 ÷ 3 = ____

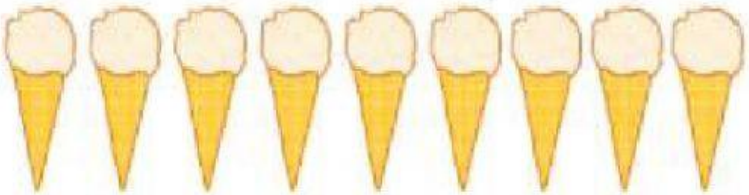

4) 12 ÷ 6 = ____

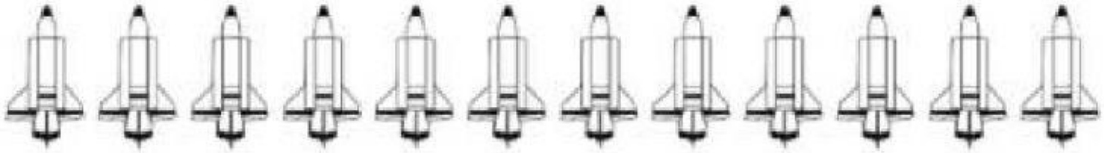

5) 5 ÷ 5 = ____

6) 15 ÷ 3 = ____