ZLOMKY

1. Vytvoř správné dvojice zlomku a zobrazení.

$\frac{1}{4}$ 

$\frac{1}{2}$

$\frac{2}{5}$ 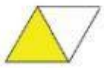

$\frac{3}{6}$

$\frac{5}{8}$

$\frac{4}{9}$

$\frac{3}{8}$

$\frac{1}{6}$

2. Která zobrazení patří k sobě?





3. Porovnej:

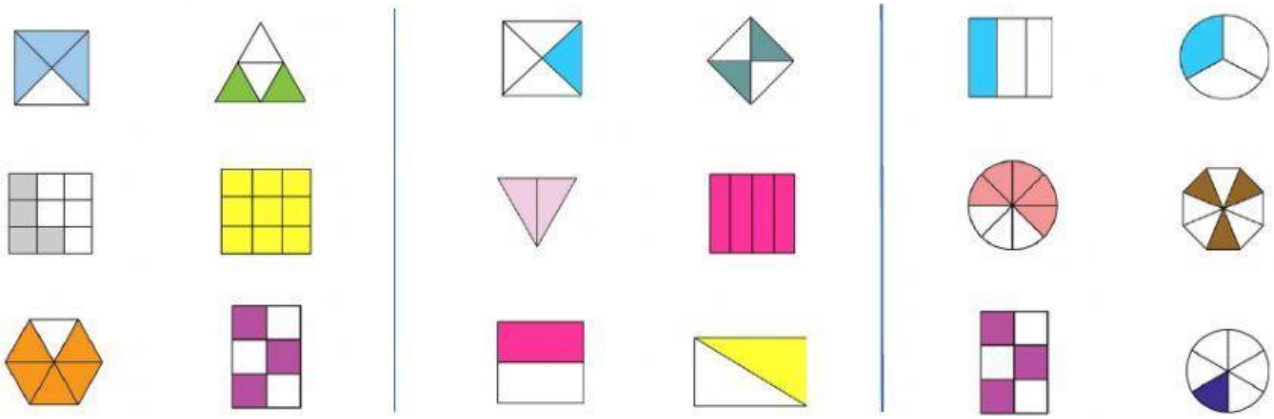

4. Porovnej zlomky:

$\frac{1}{5}$ $\frac{1}{7}$ $\frac{1}{2}$ $\frac{1}{3}$ $\frac{1}{10}$ $\frac{1}{9}$ $\frac{1}{25}$ $\frac{1}{24}$