Nama : _____ Kelas : _____

Penggunaan Alat Pengukur

Terdapat banyak alat pengukur untuk mengukur kuantiti fizik.

Padankan setiap alat pengukur dengan kuantiti fizik yang diukur dan unit ukuran.

Kuantiti yang diukur
Panjang
Jisim
Masa
Suhu
Arus elektrik
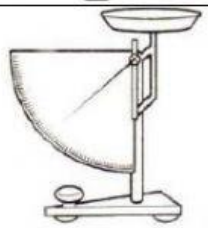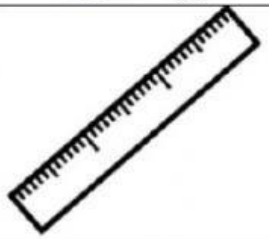
Alat pengukur	Unit ukuran