¿Con qué lo medirías?

cm = centímetro

m = metro

Km = Kilómetro

m	cm	km



m	cm	km

m	cm	km

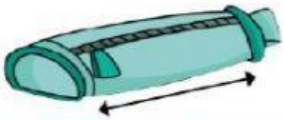

m	cm	km

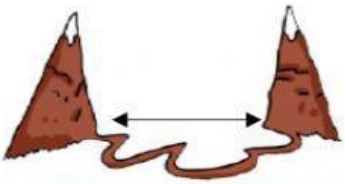

m	cm	km

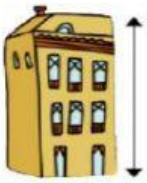

m	cm	km

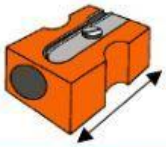

m	cm	km

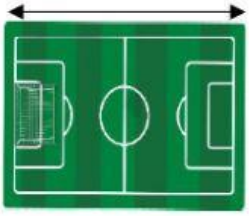

m	cm	km

m	cm	km

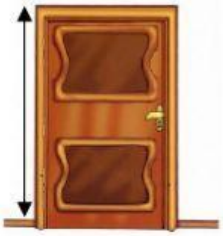

m	cm	km

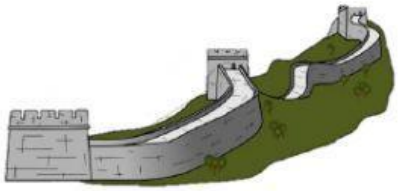

m	cm	km

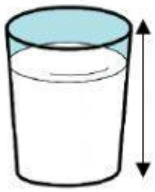

m	cm	km