Figuras 3D y sus elementos

Nombre: _____Fecha:_____/_____/_____

I. Completa la cantidad de elementos de los siguientes cuerpos geométricos.
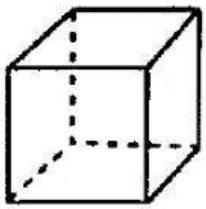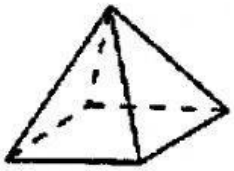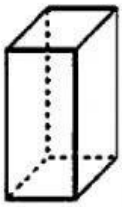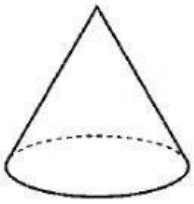
	Nombre de la figura	Elementos		
		Caras	Aristas	Vértices