Indus International School, Pune

Grade – 4

Name: _____ Acer Practice Date: _____

Task: Read the questions carefully and choose the correct answer: -

1. A doorman works according to the following schedule: he works for 4 consecutive days and has the fifth day off. Last Sunday he had the day off, and on Monday he started work according to his schedule. After how many days, including that Monday, will he have a day off on Sunday again?
   A. 12
   B. 34
   C. 30
   D. 36
2. 26 – 6 = 12 + _____
   What is the missing number?
   A. 6
   B. 8
   C. 20
   D. 32
3. Radhika wants to increase the number 564,278 by ten thousand. Which digit will change?
   A. 2
   B. 6
   C. 5
   D. 7
4. Perimeter of the figure given here is

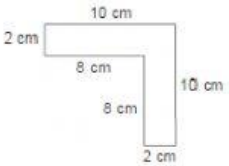

   A. 40 cm B. 50 cm
   C. 45 cm D. 55 cm
5. Justin solved the problem below. Which expression could be used to check his answer?

$$3\overline{)1364}^{\,454} \text{ : Remainder = 2}$$

   A. (454 x 3) +2 B. (454 x 2)+3
   C. (454 + 3) x 2 D. (454 + 2) x 3
6. Aunt Ruby's clock is shown here. If her niece is going to pick her up in 30 minutes, what time will be shown on the clock?
   A. 12: 10 B. 12: 70 C. 1: 10 D. 1: 60

English - Reading Section

Read the passage carefully and choose the correct answer.

'Hey, Addo, look what I found,' she said, pulling a key from one of her many pockets. I didn't ask her where she 'found' it. It was better that I didn't know. 'Do you want to take out a rowing boat?' she asked. But a question from Aunt Casey was not a question: it was a suggestion that was always going to be

Indus International School, Pune

Grade – 4

Name: _____ Acer Practice Date: _____

enacted. She knew it, and so did I. It was her enthusiasm that made her impossible to resist; it infected all those around her, especially me. 'I know we are only supposed to be strolling along the river …' She had unlocked the shed and single-handedly pulled a boat down to the sandy bank before she had finished her sentence. '… but I thought it was high time my favourite nephew and I had a bit of fun!' 'Are you sure? After last time?' But my attempt to put the brakes on this was purely token. I was already in the boat when I questioned her. There was nothing better than hanging out with AuntCasey, even if it always meant me putting my life in danger, perhaps because it meant me putting my life in danger. 'Shouldn't we have life-jackets?' But she had pushed us off. Jumping into the boat, the bottom of her trousers sopping wet, she dismissed my arguments with a wave of her hand. She stood at the back of the boat, feet apart, rocking from side to side. She wasn't trying to scare me; she was trying to scare herself. My emotions were secondary. 'Let's head for the other bank,' she said throwing her arm in the direction of an old twisted tree, her momentum almost tipping us out of the boat. 'Be a darling and row for me. A strong, young lad like you should be able to row there in no time.' It was at this point that I realised there were no oars in the boat. And when I pointed this out to Aunt Casey, all she could do was laugh.

1. Which word best describes Aunt Casey's attitude to life?
   A. reckless B. intolerant C. thoughtful D. responsible
2. Why didn't Addo ask Aunt Casey where she found the key?
   A. He expected she might take too long to explain.
   B. He knew if he asked he would sound ungrateful.
   C. He realised she had done something mischievous.
   D. He thought she would not answer him truthfully.
3. What is Addo most likely thinking at the end of the text?
   A. Aunt Casey did this on purpose.
   B. This has turned into the best day ever.
   C. I can't wait to tell my parents about this.
   D. I knew something like this would happen.

Sport in the United Arab Emirates

Grammar: Choose the correct word or words for each blank space: -

Neither camel racing, falconry ___1___ cricket is the most popular sport in the United Arab Emirates (UAE). Football is the national sport ___2___ endurance horse racing and tennis are very popular. The UAE ___3___ qualified for the football World Cup in 1990, but also for several World Youth Cup finals since then.

1.	A. or	B. nor	C. but	D. and
2.	A. even	B. despite	C. because	D. although
3.	A. also	B. when	C. before	D. not only

Indus International School, Pune

Grade – 4

Name: _____ Acer Practice Date: _____

Vocabulary: For questions 1 to 3, which of the words has a meaning most similar to the word in bold?

1. The outcome will be a **deterrent** to others.
   A. surprise B. warning C.challenge D. disappointment
2. Her outlook is **parochial**.
   A. narrow B. unique C. mature D. typical
3. He is **unequivocal** in his support for the project.
   A. vague B. absolute C. emotional D. respectful

Spelling: For questions 1 to 3, choose the correct word for each blank space.

The __1__ ancient site of Petra is Jordan's most famous tourist attraction. There are many examples of rock-cut __2__ in the city. Over the years, __3__ have uncovered a network of conduits that were built to supply water.

1. A. uninhabitid B. uninhabited C. uninhabitted D. uninhabbited
2. A. architekture B. architeckure C. architecsure D. architecture
3. A. excavations B. excavasions C. ekcavasions D. ekscavations

Science

1. Which of these would be best to measure the length of a classroom?

piece of wood
A

30 cm ruler
B

tape measure
C

rope
D

2. Kitten → cat so chick →?
   A. seal B. fish C. bird D. horse
3. Camouflaged animals look like the things around them. Where would this camouflaged insect most likely live?
   A. in a tree B. on a beach
   C. under water D. in a desert

4. How does camouflage help this insect to survive?
   A. It makes it easier for the insect to eat food.
   B. It makes it hard for insect-eaters to find it.
   C. A larger body helps this insect to move about.
   D. It makes it easier for this insect to find other insects.

5. Which property of air allows hot air balloons to float?
   A. air traps the warmth of the sun
   B. air is important for breathing
   C. air is a mixture of gases
   D. warm air rises

Indus International School, Pune

Grade – 4

Name: _____ Acer Practice Date: _____

6. Vishal wanted to look more closely at the tadpoles. He put some tadpoles into water. What would be the best container to use?

   A. a cardboard box
   B. a covered metal container
   C. a plastic container with a net over the top
   D. a plastic box with small holes in the bottom

7. Rubber, glass and plastic are good –

   A. Conductors B. Generators C. Insulators D. Electromagnets

8. A force that pulls two objects together is –

   A. Speed B. Friction C. Force of attraction D. Inertia

Logical Reasoning

1. If 'a' means '+' ; 'b' means '–' and 'd' means '×' then the expression - 16a 4b 4d2 =

   A. 10 B. 7 C. 12 D. 2 ½

2. Look at the series: 3, 9, 27, 81, _____. What number should come next?

   A. 243 B. 162 C. 324 D. 216

3. RQP, ONM, LKJ, _____, FED

   A. IHG B. CAB C. JKL D. GHI

4. Cup is to coffee as bowl is to

   A. dish B. soup C. spoon D. food

Directions: Choose the picture that would go in the empty box so that the two bottom pictures are related in the same way as the top two are related.

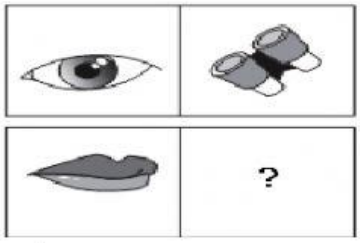

(1) (2) (3) (4)



(1) (2) (3) (4)