Name : .....

Mixed Numbers

Write mixed number for each model:

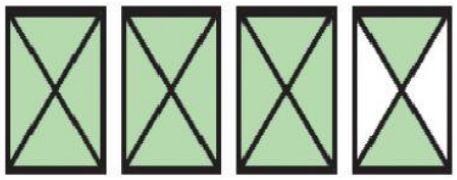

.....

.....

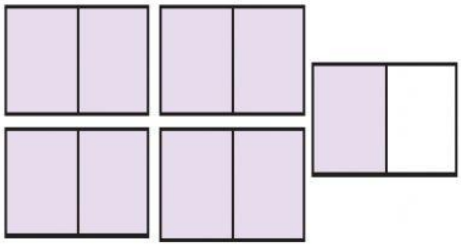

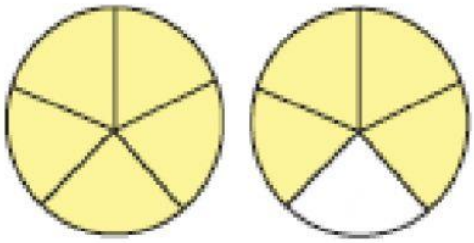

Write an equation that represent each mixed number as a sum of whole number and unit fractions :

$4\frac{1}{4} =$ (+)

$1\frac{5}{6} =$ (+ + + + +)