# Suma de números de dos cifras

| D | U |
|---|---|
| 2 | 5 |
| + 1 | 2 |

| D | U |
|---|---|
| 2 | 5 |
| + 1 | 2 |
| | 7 |

| D | U |
|---|---|
| 2 | 5 |
| + 1 | 2 |
| 3 | 7 |

- Coloco los números.
- Primero, sumo las unidades.
- Después, sumo las decenas.

## Calcula las sumas.

25 + 23 = ☐

32 + 17 = ☐

17 + 31 = ☐

23 + 14 = ☐

## Une con flechas correctamente.



línea poligonal abierta

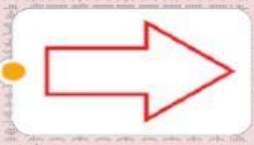

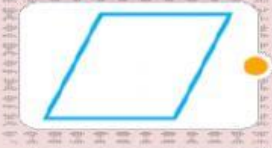

línea poligonal cerrada



## Une con flechas a cada animal con su posición.

Interior | Exterior | Frontera