F 选出适当的测量工具，画线连一连。 1.1.3 TP 1, 2 课本第 3 页

1

2



3

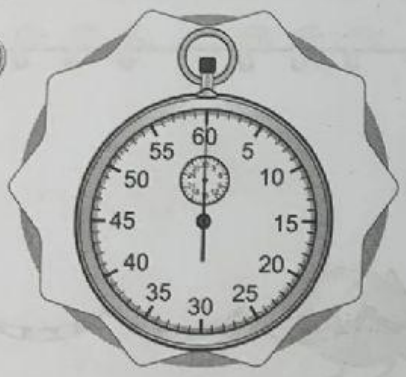

4

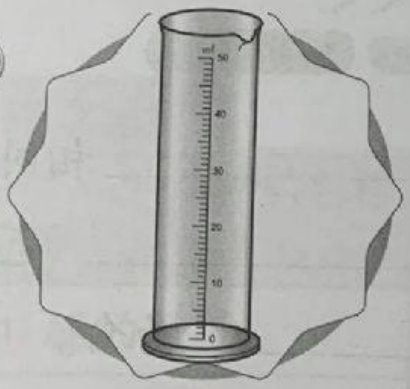

5

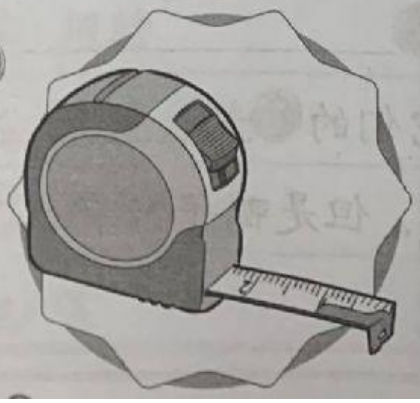

- a 赛跑的速度
- b 体重
- c 榴莲的质量
- d 白板的边长
- e 水的体积