Mathematics HW

Tens and Ones Forty Family Numbers

Instructions: Type how many tens and ones.

A.

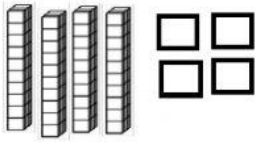

Tens	Ones

= _____

B.

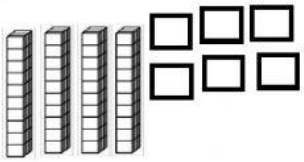

Tens	Ones

= _____

C.



Tens	Ones

= _____

D.

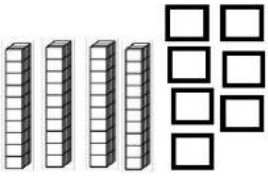

Tens	Ones

= _____

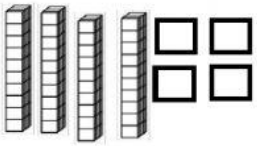

E.

_____tens _____ones = ____

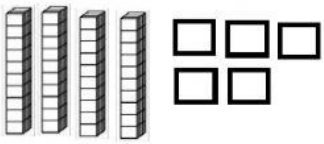

F.

_____tens _____ones = ____

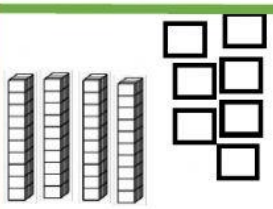

G.

_____tens _____ones = ____



H.

____tens _____ones = ____