1. **Count the number of lines in the following figure.**

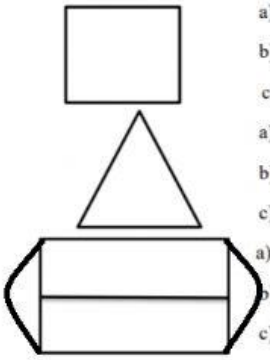

a) Standing lines ☐

b) Sleeping lines ☐

c) Slanting lines ☐

a)Standing lines ☐

b)Sleeping lines ☐

c)Slanting lines ☐

a)Standing lines ☐

b)Sleeping lines ☐

c)Slanting lines ☐

d) Curved lines ☐

2. **Count the number of horizontal lines, vertical lines and slanting lines in the blanks.**

(a)

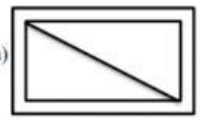

Horizontal line: ☐

Vertical Line: ☐

Slanting line: ☐

(b)

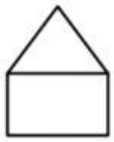

Horizontal line: ☐

Vertical Line: ☐

Slanting line: ☐

(c)

Horizontal line: ☐

Vertical line: ☐

Slant line: ☐

Curved line: ☐