Suma repetida.

Escribe la suma que represente las imágenes en los recuadros.

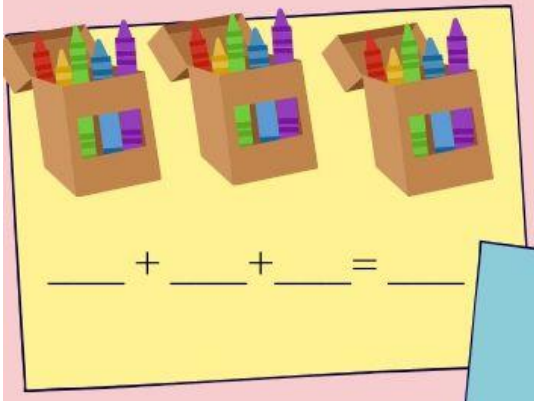

___ + ___ + ___ = ___



___ + ___ += ___

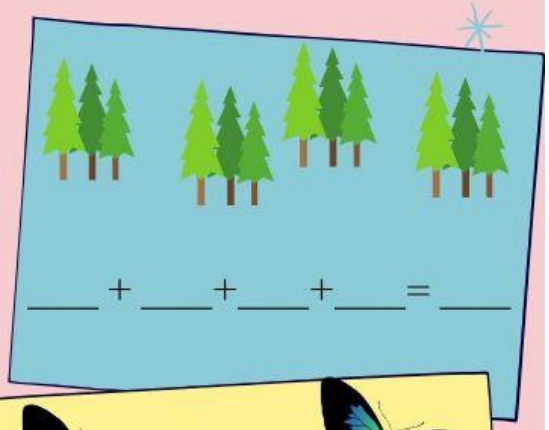

___ + ___ + ___ + ___ = ___



___ + ___ = ___

___ + ___ = ___