FIȘĂ DE LUCRU

DȘ (ACTIVITATE MATEMTICĂ)

1.Pune oamenilor de zăpadă tot atâția nasturi cât îți indică cifra de pe pălărie.



2.Selectează cifra care corespunde numărului de elemente.



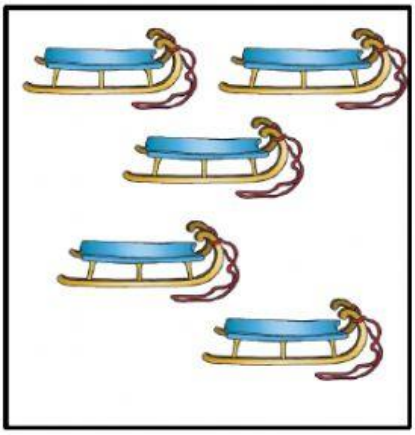

1	5	3