CUADRILATEROS Y TRIÁNGULOS

Apliquemos lo aprendido

INSTRUCCIÓN: Relaciona cada imagen con su descripción correspondiente.
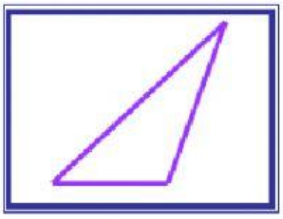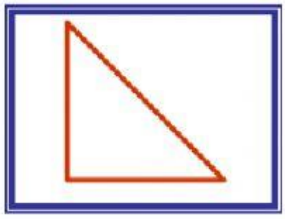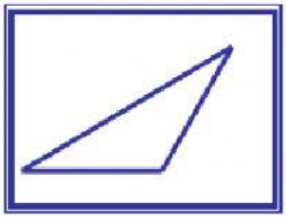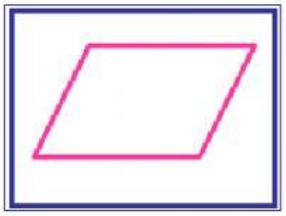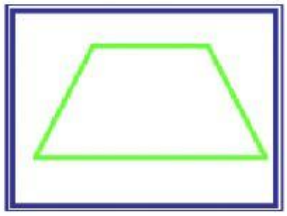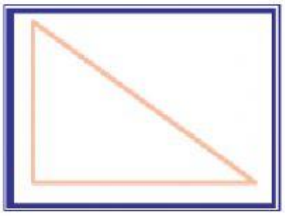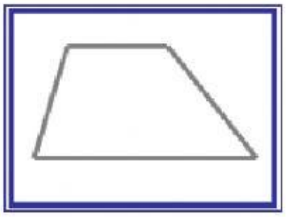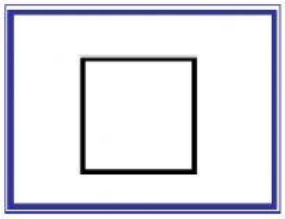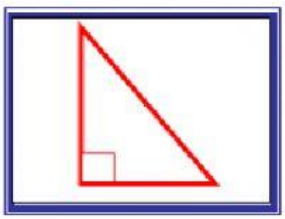
TRIÁNGULO RECTÁNGULO ISOSCELES	TRIÁNGULO RECTÁNGULO ESCALENO	TRIÁNGULO EQUILÁTERO	TRIÁNGULO ISÓSCELES OBTUSÁNGULO
TRIÁNGULO ESCALENO OBTUSÁNGULO	CUADRILATERO CON UNA SOLA MEDIDA	PARALELOGRAMO NO RECTÁNGULO NO ROMBO	NO PARALELOGRAMO
NO PARALELOGRAMO CON UN PAR DE LADOS OPUESTOS IGUALES	TRIANGULO ISÓSCELES ACUTÁNGULO	TRIÁNGULO CON ÁNGULO DE 90°	CUADRILATERO CON CUATRO ÁNGULOS DE 90°