Fracciones

Tened mucho cuidado con las faltas de ortografía: tildes, mayúsculas, etc...

Escribe cómo se lee cada fracción.

- $\frac{2}{8}$ _____
- $\frac{8}{10}$ _____
- $\frac{5}{9}$ _____
- $\frac{3}{6}$ _____
- $\frac{4}{5}$ _____
- $\frac{5}{12}$ _____

Escribe la fracción que corresponda a cada dibujo.

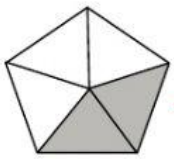

$\frac{\square}{\square}$

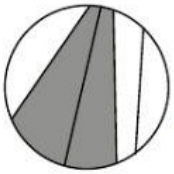

$\frac{\square}{\square}$

$\frac{\square}{\square}$

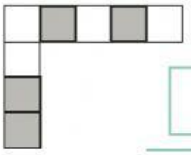

$\frac{\square}{\square}$



$\frac{\square}{\square}$



$\frac{\square}{\square}$

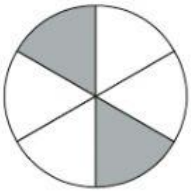

$\frac{\square}{\square}$

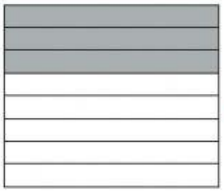

$\frac{\square}{\square}$

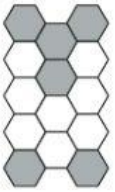

$\frac{\square}{\square}$