Mass

I. Choose whether to use **grams** or **kilograms** in measuring the following objects.

_____ 1. carrots

_____ 2. peanuts

_____ 3. newspaper

_____ 4. puppy

_____ 5. backpack

II. Answer the questions below.

1. Which scale shows the greatest mass?

A



a. Scale A

B



b. Scale B

C



c. Scale C

2. What is the total mass shown on the three given scales?







☐ + ☐ + ☐ = ☐

3. How much heavier are the doughnuts than the cookies? Show your solution.