Ficha Intervalos 8

1.- Indica el número y la especie de los siguientes Intervalos





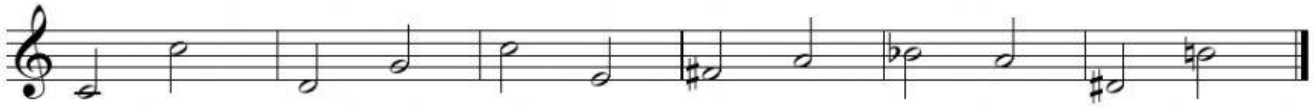

2.- Realiza los siguientes Intervalos