Aku Bisa!

Perhatikan gambar berikut!
Hitunglah banyak makanan ini!
Lingkari tiap 10 buah makanan!
Lalu, hitunglah sisanya!
Jumlahkan dengan makanan yang dilingkari!
Tuliskan angkanya pada kotak!

Contoh:

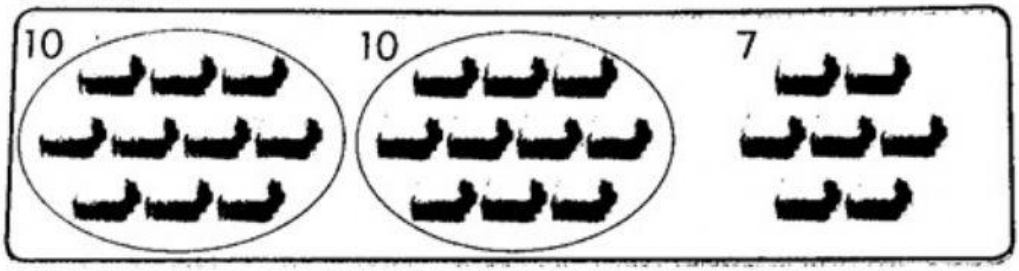

20 + 7 = 27



... + ... = ☐



... + ... = ☐

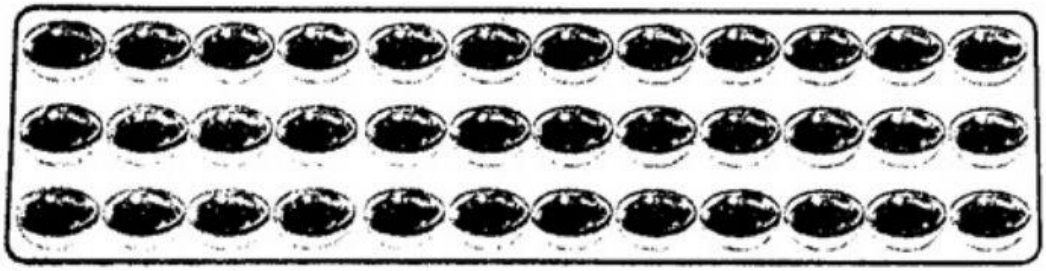

... + ... = ☐

Sumber: Dokumen Penerbit