# Restas con centenas

Resuelva las siguientes restas utilizando el material base 10 y escriba en la tabla

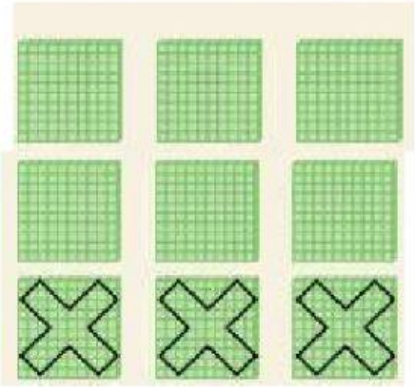

| C | D | U |
|---|---|---|
| | | |
| | | |
| | | |

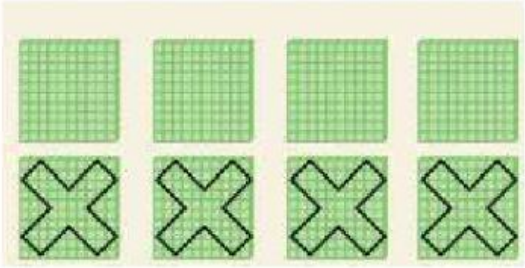

| C | D | U |
|---|---|---|
| | | |
| | | |
| | | |

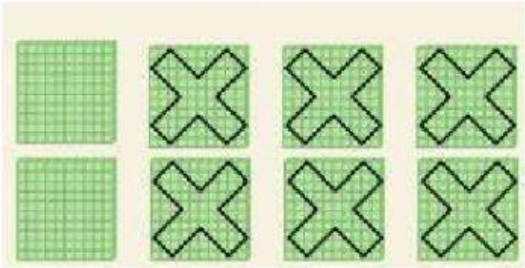

| C | D | U |
|---|---|---|
| | | |
| | | |
| | | |