**OGNI BICCHIERE CONTIENE 10 CUBETTI DI GHIACCIO ( OGNI BICCHIERE E' UNA DECINA) : QUANTI CUBETTI SONO SOLI SOLETTI SULLA TAVOLA ( LE UNITA' )? QUANTE SONO LE DECINE?**




| da | u |
|---|---|
| | |

**0 1 2 3 4 5 6 7 8 9**




| da | u |
|---|---|
| | |

LIVEWORKSHEETS




| da | u |
|---|---|
| | |




| da | u |
|---|---|
| | |




| da | u |
|---|---|
| | |

LIVEWORKSHEETS