# FIȘĂ DE LUCRU – ÎNVELIȘUL DE ELECTRONI

**Determinați pentru următoarele elemente configurația electronică (repartiția electronilor pe straturi) pentru următoarele elemente:**

**a) B (Z = 5)**



**Stratul 1(K)**

**Stratul 2(L)**

**b) He (Z = 2)**

**Stratul 1(K)**

**Stratul 2(L)**

c) Mg (Z = 12)

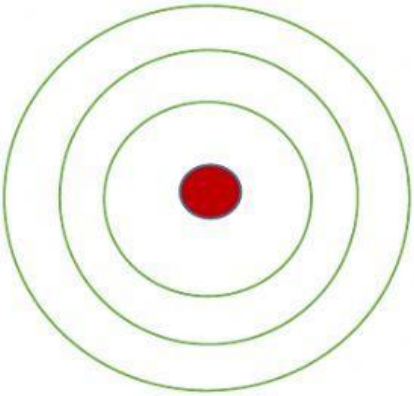



Straul 1(K)

Stratul 2(L)

Stratul 3(M)

d) Ne (Z = 10)

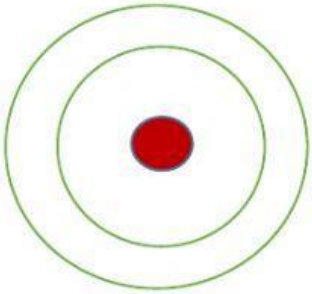

Stratul 1(K)

Stratul 2(L)