مدرسة سبرينغ دايلز دبي
SPRINGDALES SCHOOL DUBAI

Name: _____ Grade 1 _____

Practice Worksheet

Match with the correct answer: (Line must touch the arrow for the answer)

1) Take away 4 from 8 =	➢ **4 ones** ➢ **4 tens** ➢ **4tens and 4 ones**
2) 76 – 1=	➢ **75** ➢ **70** ➢ **78**
3) Choose the correct number sentence: 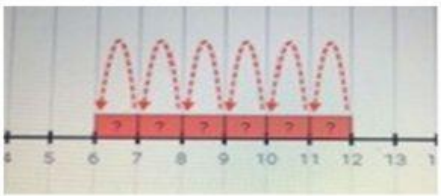	➢ **12 - 5** ➢ **12 - 6** ➢ **12 - 10**

4) **T O** **7 8** **- 2 4** _____	➢ **5 +40** ➢ **5 tens** ➢ **50+ 4**
5) **T O** **6 9** **- 3 4**	➢ **35** ➢ **45** ➢ **25**
6) Choose the correct number line for the given number sentence. **15 – 5 =**	➢ ➢ 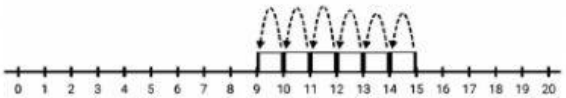 ➢ 
7) There are 40 students in a class. 33 of them went for the school trip. How many left? 	➢ **40 – 33 = 9** ➢ **40 – 33 = 10** ➢ **40 – 33 = 7**

8) There were 17 people standing in a queue outside a bank. 12 of them went inside. How many are still in the queue? 	➢ **50** ➢ **5 - 0** ➢ **5 +1**
9) There were 25 guests at a birthday party. 18 of them left. How many guests are still there? 	➢ **18 – 25 = 7** ➢ **25 – 7 = 18** ➢ **25 – 18 = 7**
10) Difference between 30 and 20 is	➢ **10** ➢ **20** ➢ **15**