Nama: _____

Kelas: _____

TOPIK: MESIN

Tonton video di bawah dan jawab soalan-soalan berikut.

A) Padankan gambar dengan jenis takal dengan betul. (Rujuk buku teks muka surat 135).

1.

Takal bergerak

2.

Takal tetap

3. 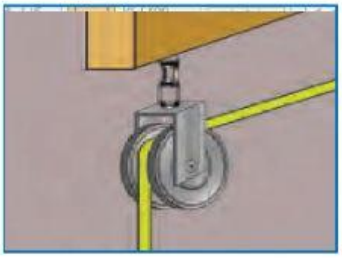

Takal bergabung

B) Padankan rajah berikut dengan jenis takal yang digunakan.

1.

Takal bergerak

2.

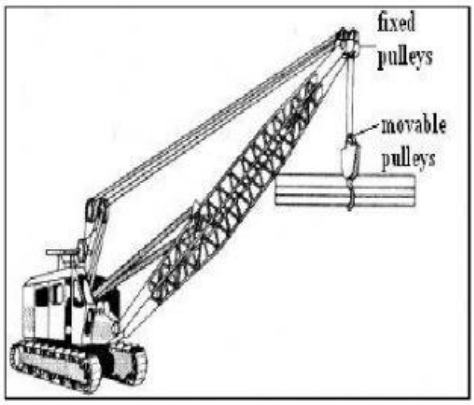

Takal tetap

3.



Takal bergabung