JAWAB SEMUA SOALAN.

1. Yang manakah objek bagi Q dengan menggunakan skala 1 : 3

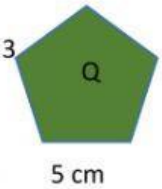

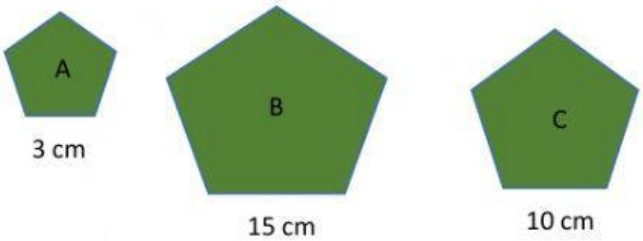

JAWAPAN : _____

2. Yang manakah lukisan berskala bagi objek F dengan menggunakan skala 1: 1/2?

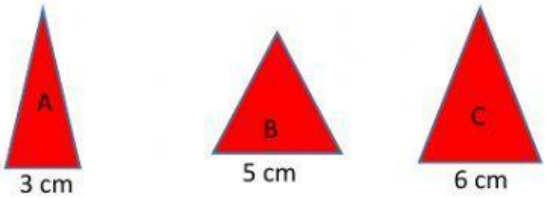

JAWAPAN : _____

3. Yang manakah lukisan berskala bagi objek P dengan menggunakan skala 1 : 5

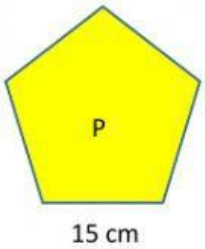

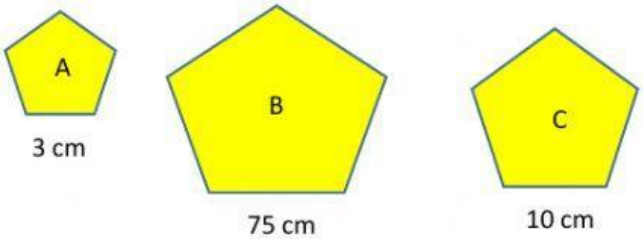

JAWAPAN : _____

4. Yang manakah objek bagi E dengan menggunakan skala 1:2?

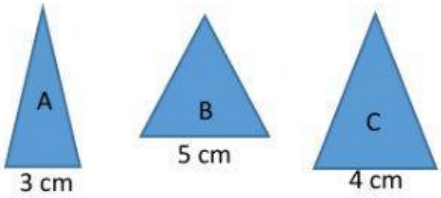

JAWAPAN : _____