Alquenos

1. Indique la formula global de un alqueno que presenta 5 enlaces dobles y 15 carbonos

2. Determine la atomicidad del 1,3,5-undecatrieno

3. ¿Cuantos enlaces dobles presenta el compuesto C_5H_6?

4. Nombrar CH2=CH-CH2-CH3

5. Nombrar CH3-CH2-CH=CH-CH3

6. Nombrar CH3-CH=CH-CH2-CH2-CH=CH-CH=CH2

7. Nombrar

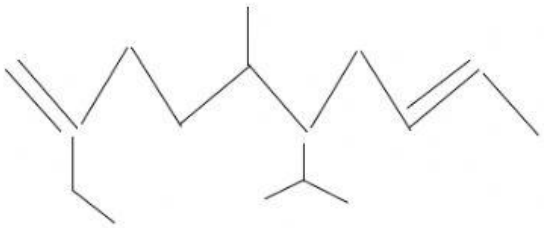

8. Nombrar

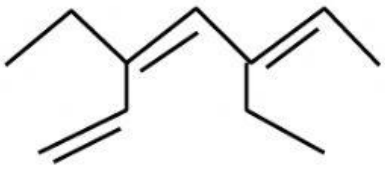

9. Nombrar

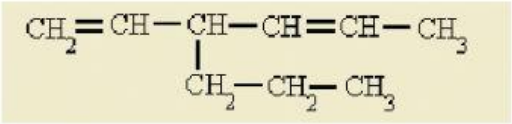
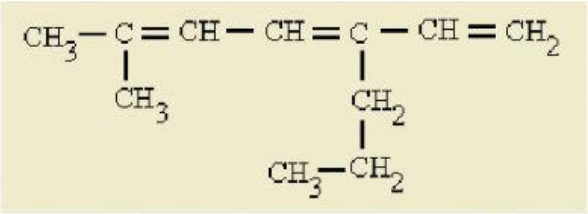
10. Nombrar