INICIANDO A DIVISÃO

1. Selecione a opção em que foram circulados, exatamente, metade dos elementos do grupo.

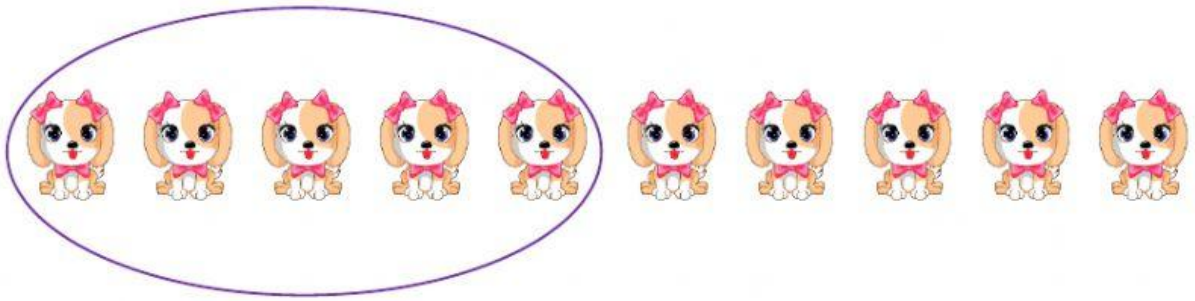

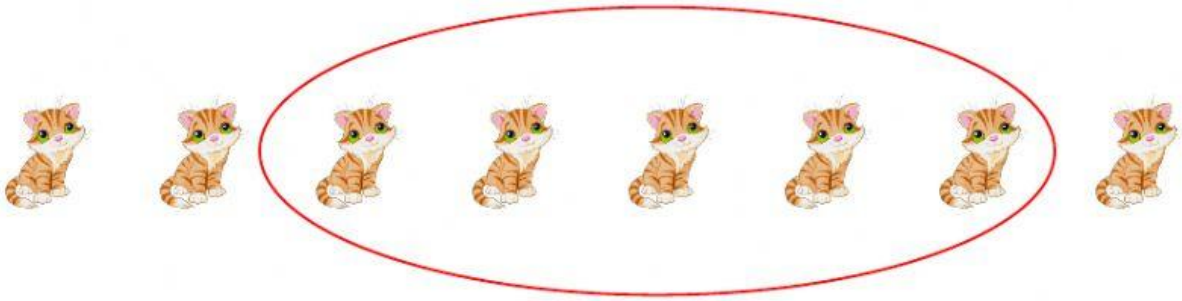







2. Observe cada quadro e complete:



A metade de 2 é



A metade de 8 é



A metade de 4 é



A metade de 6 é



A metade de 12 é



A metade de 10 é

3. Complete as sentenças, de acordo com os desenhos.



6 ÷ 2 =



2 ÷ 2 =



4 ÷ 2 =



8 ÷ 2 =