DECIMALES

Unir las fracciones con su respectivo número decimal.

$\frac{3}{10}$	**0,9**
$\frac{12}{10}$	**2,3**
$\frac{8}{10}$	**0,3**
$\frac{9}{10}$	**1,5**
$\frac{23}{10}$	**0,8**
$\frac{1}{10}$	**1,2**
$\frac{15}{10}$	**0,1**

$\frac{35}{10}$	**0,5**
$\frac{42}{10}$	**4,8**
$\frac{6}{10}$	**3,5**
$\frac{10}{10}$	**0,2**
$\frac{48}{10}$	**4,2**
$\frac{5}{10}$	**1,0**
$\frac{99}{10}$	**0,6**
$\frac{2}{10}$	**9,9**

Escribir el número decimal que se encuentra en el punto indicado en la recta numérica.

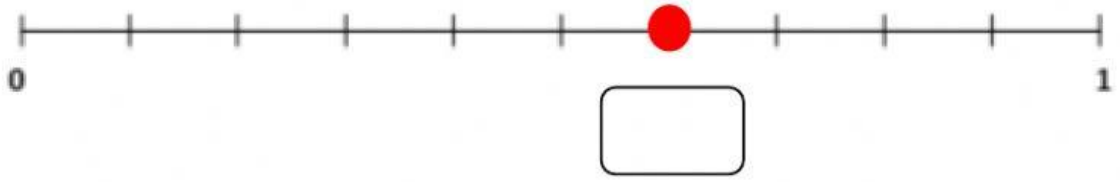



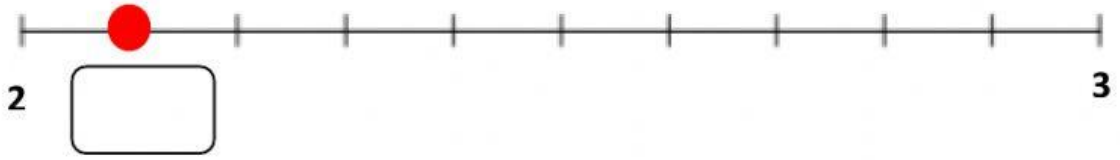

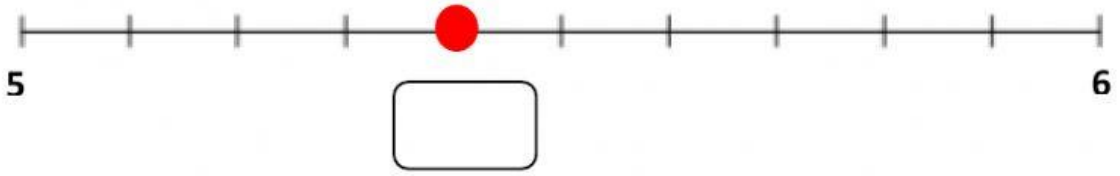

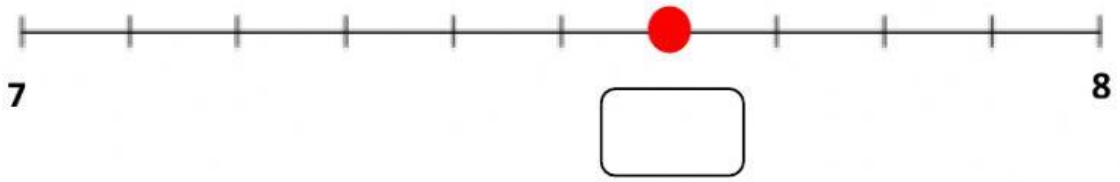
7
8

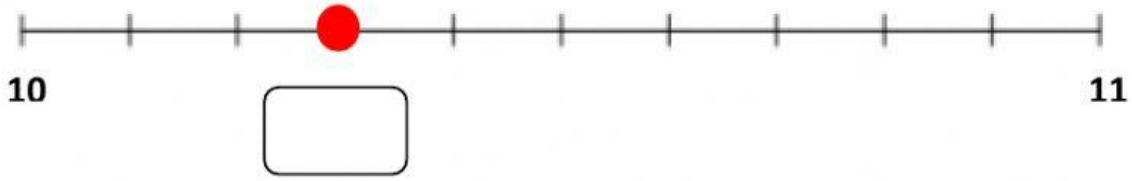
10
11


9
10

4
5

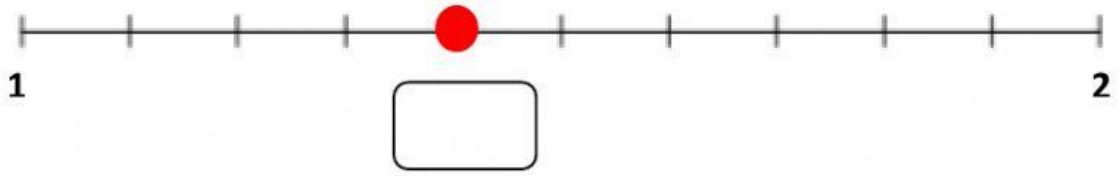
1
2