HUMAN BODY SYSTEMS WORKSHEET.

Name:_____ Date:_____

1. Complete the following statement about the body systems?

   The of an consist on a number of that work together to keep it .

body	alive	Systems organs	organism

2. Identify the name of each body system and match them with its corresponding function.

Select the name:	Select the name:
Function:	Function:

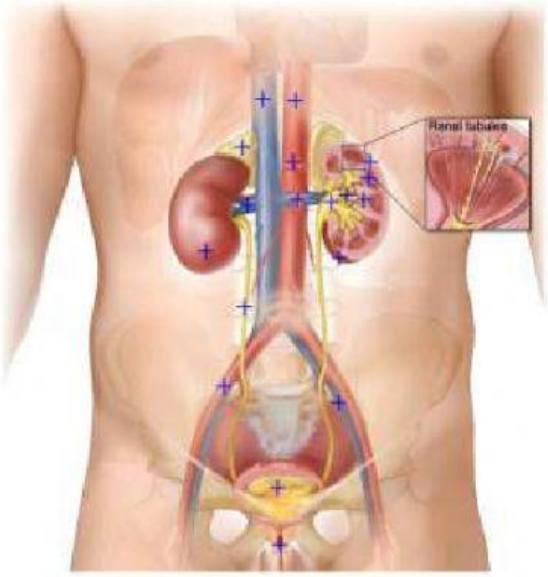	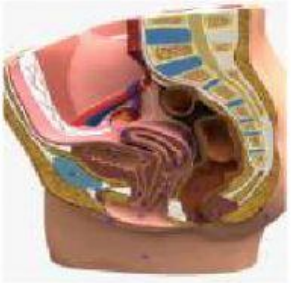 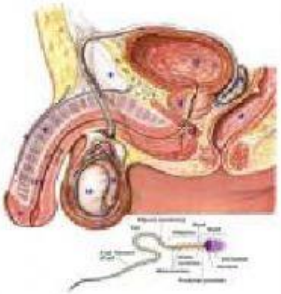
Select the name:	Select the name:
Function:	Function:
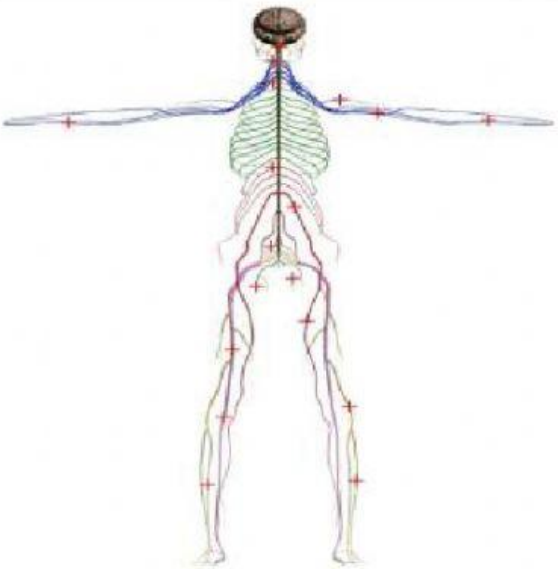	
Select the name:	Select the name:
Function:	Function:

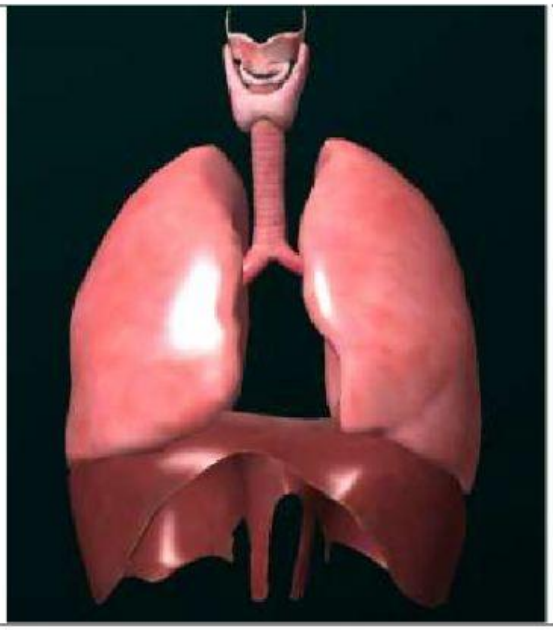	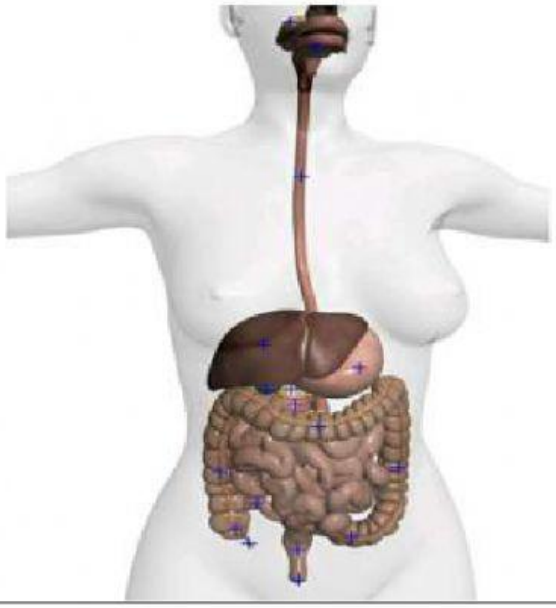
Select the name:	Select the name:
Function:	Function:

3. Match each body system with some the corresponding organs that are part of them.

Body System	Organs
Reproductive	Brain, spinal cord and nerves.
Digestive	Lungs, bronchus and trachea.
Nervous	Testicles and penis in male, ovaries and vagina in female.
Circulatory	Heart, arteries, veins and capillaries.
Excretory	Stomach, liver, small and large intestine.
Respiratory	Kidneys, ureter and bladder.