Practice 13

Reminder

The perimeter of figures with four unequal sides is computed by adding the lengths of each side.

Directions: Compute the perimeter of these parallelograms.

1.

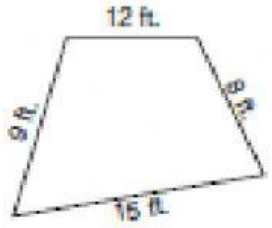

_____

2.

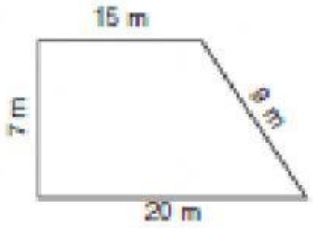

_____

3

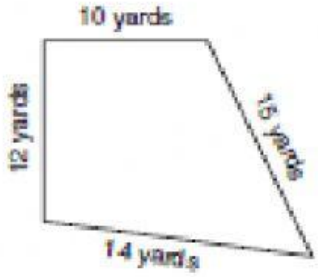

_____

4.

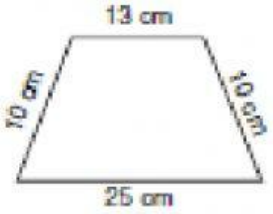

_____

5.



_____

6.

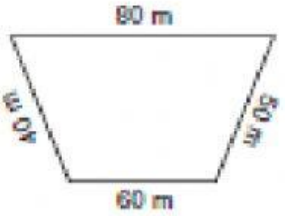

_____

7.

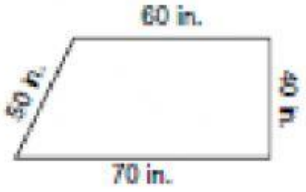

_____

8.

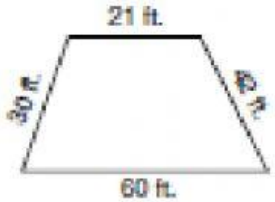

_____