Estado líquido de la materia
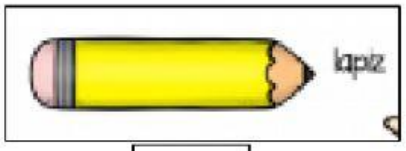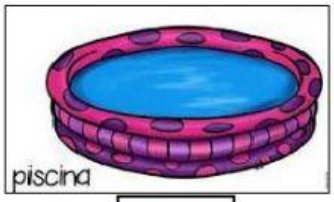
Marca una X en los dibujos que representen el estado líquido de la materia