OPERACIONES ENTRE CONJUNTOS.

Tema I. Une cada operación con el diagrama de Venn-Euler que le corresponda.

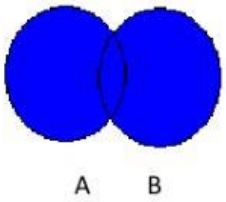

A – B

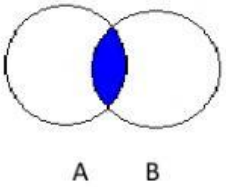

A U B

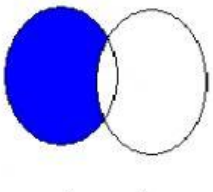

B – A

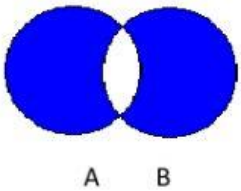

A ∆ B

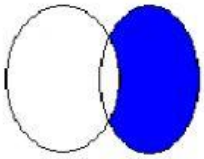

A ∩ B

Tema II. Observa el diagrama de la derecha y realiza las operaciones pedidas.

B U C _____

A – B _____

(A U C) ∩ B _____

(A – B) Δ (B U C) _____

A^c _____

