Aula de Mús



Ceip Bonavis
(Alaquàs)

1.Suma les següents figures

EXEMPLE. =

1 + ½ + ½ = 2

a) =

b) 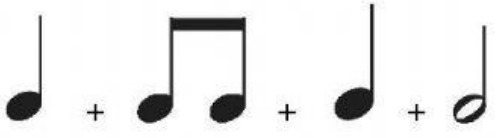 =

c) 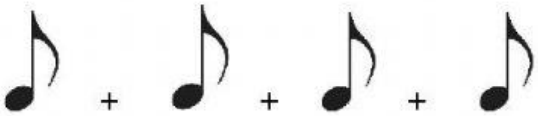 =

d) =

2.Suma els següents silencis

a) =

b) =

c) =

d) =