Worksheet 2

1 Isikan tempat kosong dengan simbol " + " atau " − ".

[4 markah]

Jawapan :

(a)	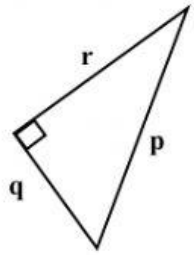	$r^2 = p^2 \square q^2$
(b)	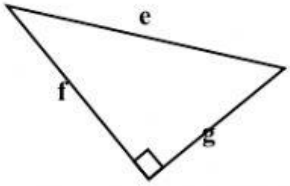	$e^2 = f^2 \square g^2$
(c)	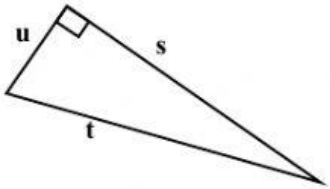	$u^2 = t^2 \square s^2$
	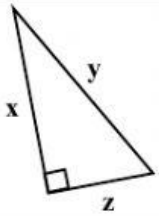	$x^2 = y^2 \square z^2$

2 Padankan masa yang betul bagi jarak dan laju yang diberikan.

[4 markah]

Laju = 44.1 km/j Jarak = 150 km	Laju = 120 km/j Jarak = 90 km	Laju = 125 m/s Jarak = 500 m	Laju = 60 km/j Jarak = 60 km
●	●	●	●
●	●	●	●
Masa : 4 saat	Masa : 3 jam 24 minit	Masa : 1 jam	Masa : 45 minit

Worksheet 2

3 Lengkapkan jujukan nombor yang berikut (3 markah)

i) ____ , 32 , 16, ____ , 4, …

ii) 0.2, 2.4, 28.8, ____, 4147.2 , …