Grade 2 Math Final Revision T1

Add

7 + 0 = _____ 6. 3 + 6 = _____ 7. 2 + 5 = _____

0 + 7 = _____ 6 + 3 = _____ 5 + 2 = _____

Doubles and near doubles facts

4 + 4 = 4 + 3 =	3 + 3 = 3 + 4 =	6 + 6 = 6 + 5 =
5 + 5 = 5 + 6 =	2 + 2 = 2 + 3 =	7 + 7 = 7 + 8 =

Make a 10 to add

12. 4 + 8

13. 9 + 5

14. 7 + 6

15. 6 + 8

Add 3 numbers

11. 5 + 5 + 5 = _____

12. 6 + 6 + 3 = _____

13. 7 + 4 + 7 = _____

14. 9 + 8 + 1 = _____

Count on to add

11. _____ = 9 + 3

12. 2 + 8 = _____

Count back to subtract

7. 3 − 2 = _____

8. _____ = 12 − 3

10. 6 − 0

11. 8 − 8

12. 9 − 0

13. 4 − 4

Subtract all and subtract zero

10. 6 − 0

11. 8 − 8

12. 9 − 0

13. 4 − 4

Use doubles to subtract

3. 6 + _____ = 12

12 − 6 = _____

4. 4 + _____ = 8

8 − 4 = _____

5. 7 + _____ = 14

14 − 7 = _____

6. 8 + _____ = 16

16 − 8 = _____

The missing addend

☐ + 4 = 8

4.

7 + ☐ = 15

Fact families

.

_____ + _____ = _____

_____ + _____ = _____

_____ − _____ = _____

_____ − _____ = _____

2.

_____ + _____ = _____

_____ + _____ = _____

_____ − _____ = _____

_____ − _____ = _____

Skip counting

Write the missing number

6, _____, _____, 12, 14, _____, 18, _____

15, 20, _____, 30, _____, 40, _____, 50

20, _____, _____, 50, _____, _____, 80, 90

_____, 55, _____, 65, _____, _____, 80

62, _____, 66, _____, _____, 72

60, _____, 70, _____, 80, _____

95, _____, _____, 80, 75, _____

88, _____, 84, _____, _____, 78

Skip counting using equal sets

6.

_____ groups of _____ _____ in all

7.

_____ groups of _____ _____ in all

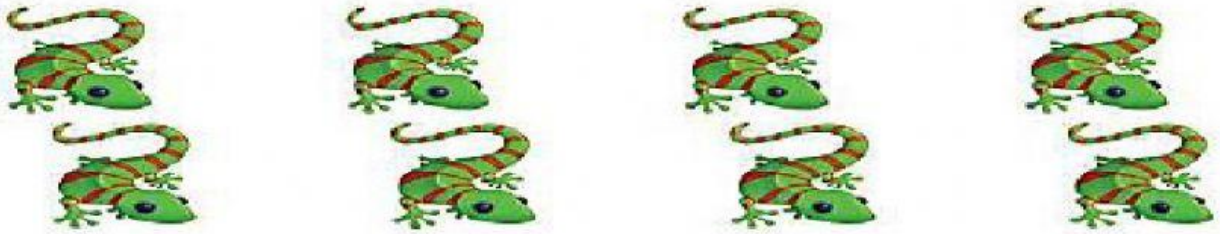

_____ groups of _____ _____ lizards in all

Repeated addition using arrays

1. 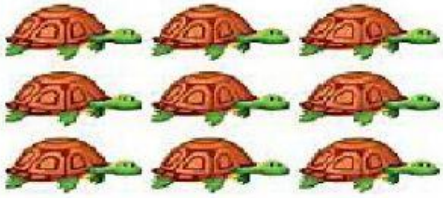

____ + ____ + ____ = ____

_____ rows of _____ turtles

2.

____ + ____ = ____

_____ rows of _____ cacti

Even and odd numbers

Even : 0,2,4,6,8 odd: 1,3,5,7,9

1.	8	even odd	2.	16	even odd
3.	11	even odd	4.	19	even odd
9.	17	even odd	10.	14	even odd
11.	8	even odd	12.	19	even odd

Sum of equal addends

11. 10 = _____ + _____	12. 14 = _____ + _____
13. 18 = _____ + _____	14. 8 = _____ + _____
15. _____ + _____ = 6	16. _____ + _____ = 4
17. _____ + _____ = 20	18. _____ + _____ = 16

Take apart tens to add

5. 67 + 26

67 + _____ + _____

_____ + _____ = _____

So, 67 + 26 = _____.

6. 38 + 14

38 + _____ + _____

_____ + _____ = _____

So, 38 + 14 = _____.

Add two-digit number to one-digit number

9.

	2	4
+		4

10.

	4	3
+		9

11.

	1	3
+		7

12.

	5	1
+		9

13.

	1	7
+		6

14.

	3	8
+		4

Add two-digit numbers

9.

	3	6
+	2	7

10.

	2	2
+	1	0

11.

	5	9
+	1	3

12.

	4	6
+	2	6

13.

	2	8
+	1	8

14.

		9
+	3	2

Vertical addition

10. 18 + 63

11. 64 + 27

12. 73 + 18

13. 56 + 23

14. 37 + 39

15. 28 + 33

Add three and four 2-digit numbers

1.
```
  53
  27
+ 10
```

2.
```
  52
  23
+ 18
```

3.
```
  11
  19
+ 24
```

4.
```
  26
  35
  24
+ 11
```

5.
```
  23
  36
  16
+ 11
```

6.
```
  23
  33
  13
+ 15
```

Two-digit fact families

4.

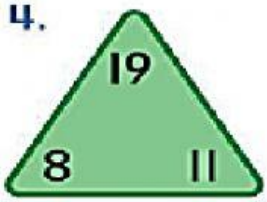

___ + ___ = ___ ___ − ___ = ___

___ + ___ = ___ ___ − ___ = ___

5.

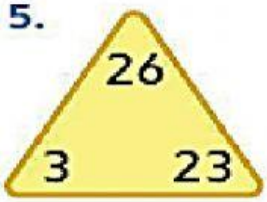

___ + ___ = ___ ___ − ___ = ___

___ + ___ = ___ ___ − ___ = ___

Take apart tens to subtract

3. 83 − 52

_____ _____

83 − _____ = _____

_____ − _____ = _____

So, 83 − 52 = _____.

4. 67 − 45

_____ _____

67 − _____ = _____

_____ − _____ = _____

So, 67 − 45 = _____.

Subtract one-digit number from two-digit number

6.

	8	8
−		2

7.

	1	5
−		9

8.

	3	1
−		6

9.

	5	8
−		9

10.

	6	6
−		7

11.

	9	5
−		5

Subtract two-digit numbers

6.

	7	5
−	1	6

7.

	5	4
−	2	8

8.

	7	2
−	3	5

7. 54
− 45

8. 27
− 9

9. 63
− 11

10. 91
− 59

11. 35
− 26

12. 87
− 42

Vertical subtraction

1. 74 − 25

2. 60 − 37

3. 86 − 48

4. 45 − 28

5. 84 − 38

6. 37 − 18

7. 24 – 7 =

8. 35 – 9 =

9. 47 – 5 =

Check subtraction

1. 67
− 48
+ ____

2. 52
− 36
+ ____

3. 80
− 68
+ ____

4. 91
− 45
+ ____

Best wishes