Name: _____ Date: _____

**Find the length of the side marked x.**

1.

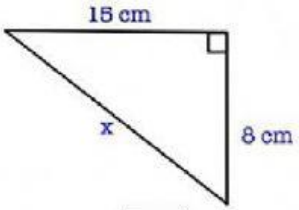


Answer: x = ____ cm.

3.

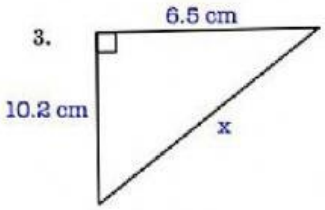


Answer: x = ____ cm.

5.

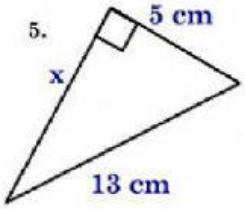


Answer: x = ____ cm.

2.

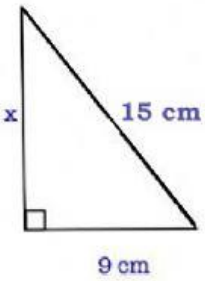


Answer: x = ____ cm.

4.

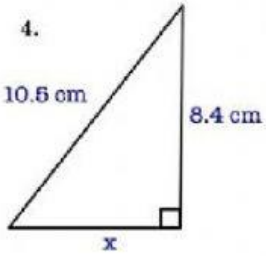


Answer: x = ____ cm.

LIVEWORKSHEETS