LA FAMILIA DEL 30

0	1	2	3	4	5	6	7	8	9
10	11	12	13	14	15	16	17	18	19
20	21	22	23	24	25	26	27	28	29
30	31	32	33	34	35	36	37	38	39

1 Consulta la tabla numérica y completa.

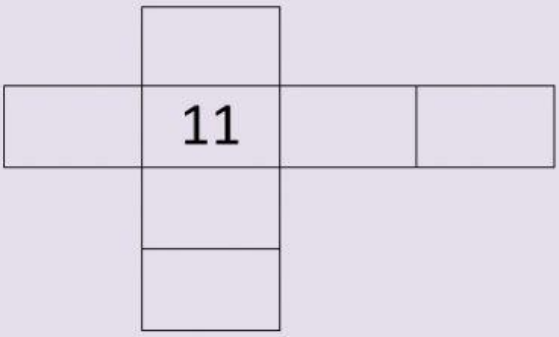

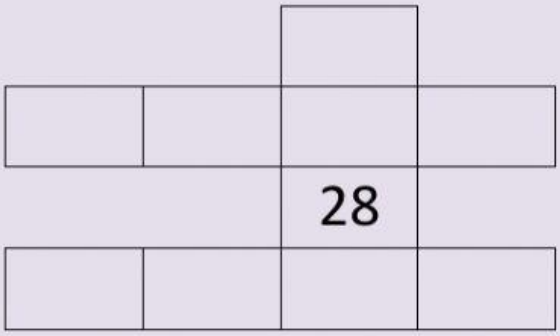

2 Pincha los globos de la familia del treinta.

3 Escribe los números anterior y posterior.

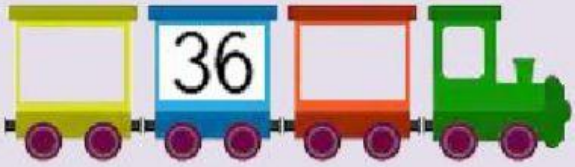

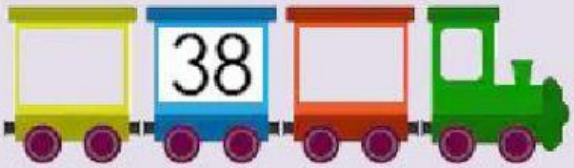

4 Pincha.