DIEVRSITATEA LUMII

1.Aranjeaza unitatile de clasificare de la cea mai mica(1) la cea mai cuprinzatoare (7)

7.

6.

5.

4.

3.

2.

1.

GEN	**CLASA**	**FAMILIA**	**ORDIN**
REGN		**SPECIE**	**INCRENGATURA**
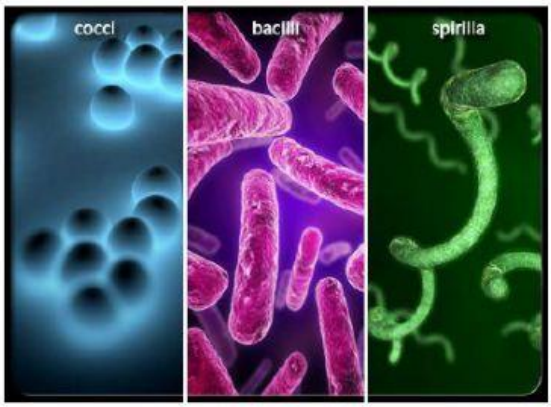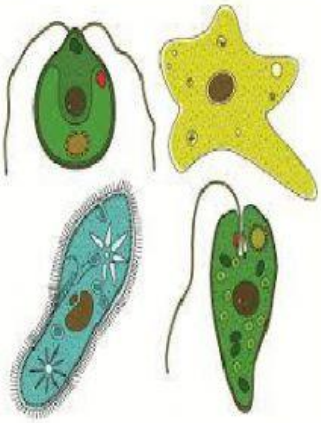
2. Identifica carui regn apartin vietuitoarele