PERCEPÇÃO MELODIA E TRÍADES

Relacione as colunas abaixo:



1

2



3

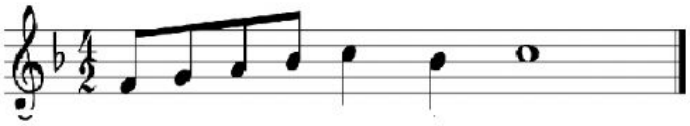

4

Qual dos dois áudios abaixo equivale a essa sequência de acordes? Escreva CERTO ou ERRADO na resposta.



A B

Ouça e escreva a ordem em que os acordes aparecem. Coloque 1,2, 3 e 4 nas respostas:

MAIOR AUMENTADO

DIMINUTO MENOR