NOMBRE:_____

Actividad:

- Escribe la fracción impropia y el número mixto que representa cada diagrama

DIAGRAMA	FRACCIÓN IMPROPIA	NÚMERO MIXTO
	$\frac{11}{5}$	$2\frac{1}{5}$
	$\frac{\square}{\square}$	$\square\frac{\square}{\square}$
	$\frac{\square}{\square}$	$\square\frac{\square}{\square}$
	$\frac{\square}{\square}$	$\square\frac{\square}{\square}$
	$\frac{\square}{\square}$	$\square\frac{\square}{\square}$
	$\frac{\square}{\square}$	$\square\frac{\square}{\square}$
	$\frac{\square}{\square}$	$\square\frac{\square}{\square}$