Mathematics
Subtraction Facts to 20

Name: _____

1. Look at the dominoes. Find the difference.

| | |
|---|---|
| A 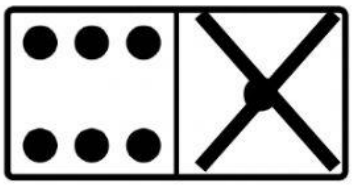 7 - 1 =_____ | B  15 - 6 =_____ |
| C 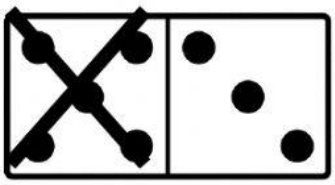 8 - 5 =_____ | D 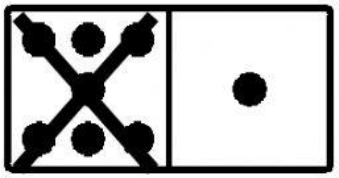 8 - 7 =_____ |

2. Find the difference.

A

10 - 4 = 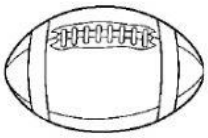

B

15 - 3 = 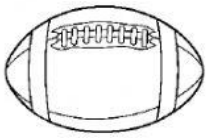

C

17 - 8 = 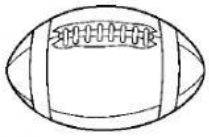

D

16 - 8 =

E

13 - 7 = 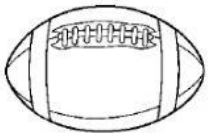

F
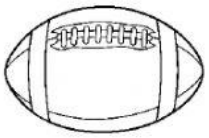
20 - 5 =