Adunarea numerelor naturale în concentrul 0 – 10

1. Calculează:

2+1= ☐☐	5+2= ☐☐	☐☐ = 6+0	☐☐ = 5+5
6+3= ☐☐	7+3= ☐☐	☐☐ = 3+3	☐☐ = 4+2
1+7= ☐☐	5+4= ☐☐	☐☐ = 6+4	☐☐ = 2+7
9+1= ☐☐	1+8= ☐☐	☐☐ = 6+2	☐☐ = 2+3

2. Încercuieşte răspunsul corect:

2 + 3 = 7 5 9	5 + 2 = 3 7 8	1 + 5 = 5 6 8
6 + 1 = 7 4 3	2 + 7 = 9 10 4	4 + 3 = 9 7 10
7 + 3 = 1 6 10	2 + 6 = 8 2 1	9 + 1 = 3 2 10
4 + 4 = 8 2 9	3 + 5 = 6 7 8	6 + 3 = 9 8 6

3. Numără şi notează numărul elementelor, apoi efectuează adunările folosind simbolurile:





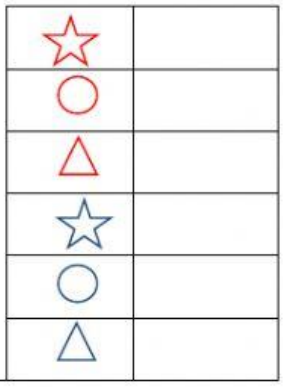

☆ + ☆ = ☐ + ☐ = ☐

○ + ○ = ☐ + ☐ = ☐

△ + △ = ☐ + ☐ = ☐

☆ + ○ + △ = ☐ + ☐ + ☐ = ☐

☆ + ○ + △ = ☐ + ☐ + ☐ = ☐

4. Rezolvă problema:

Erau:

Câte jucării sunt?

☐ + ☐ + ☐ = ☐ **R:** ☐

5. Completează casetele:

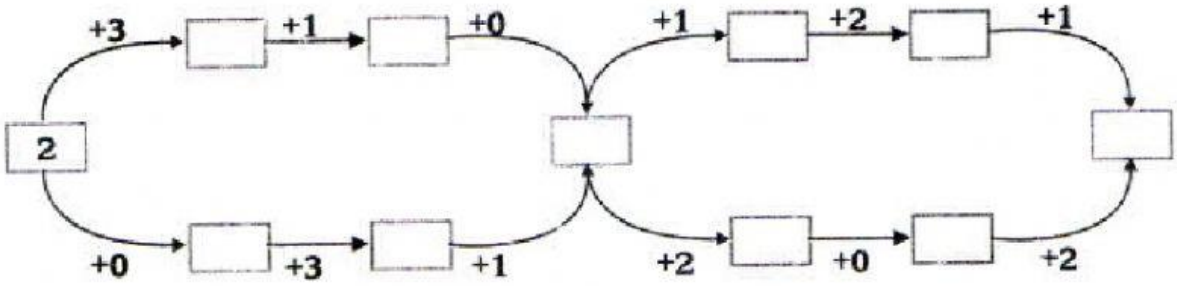

6. Colorează spațiile ținând cont de rezultatul operației:
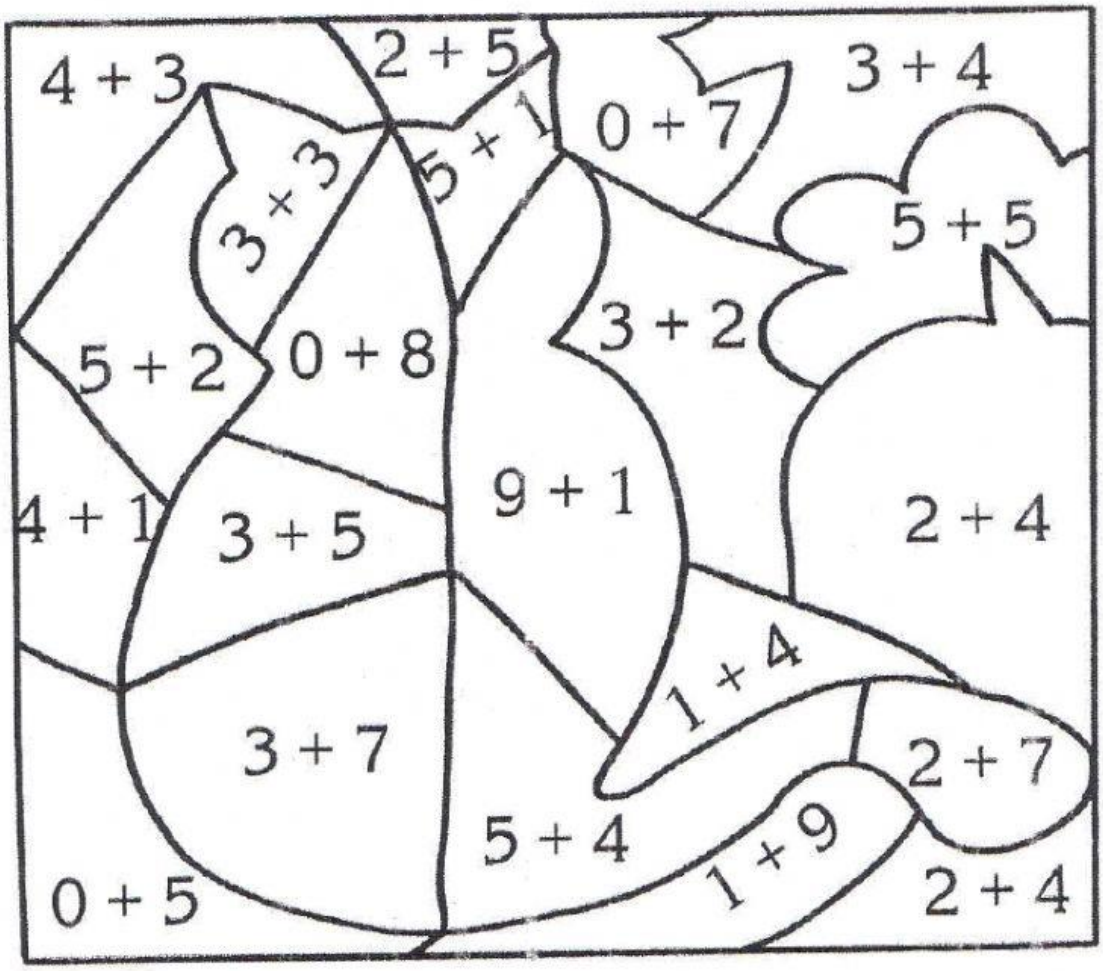
6 → 8 → 10 → 9 → 7 → 5 →